Which is cheaper?

R4,00

R0,55

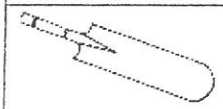
R5,50

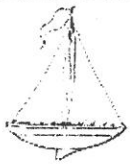
R5,05

R0,75

R0.90

R2,00

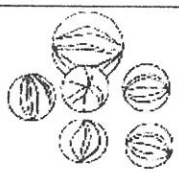
R0,25

R3,30

R3,80

R/2

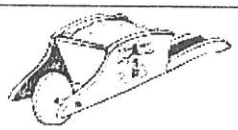
R/1,95

R/,90

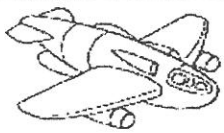
R/,95

Find the correct coins to make the following rands and cents to buy what is on the sales ticket:



○ R1,10 ball of wool

○ R1, 05 book

○ R2,30 toy car

○ 45c a toffee

○ 35c beads

○ R1,55 2 pens

○ R2,50 bucket

○ R1,10 chocolate



A. How many 10c coins have the same value as: R0.50 = 5

1. R0,30 = ____
2. R0,40 = ____
3. R0,90 = ____
4. R 1,00 = ____
5. R2,00 = ____
6. R3,00 = ____
7. R1,20 = ____
8. R1,60 = ____
9. R2,40 = ____
10. R3. 10 = ____
11. R4,50 = ____
12. R5,80 = ____

A. Write the amounts in words:

1. R1,45 One rand and forty-five cents
2. R1,82 _____
3. R6,30 _____
4. R2,51 _____
5. R1,97 _____
6. R1,33 _____
7. R4,23 _____
8. R3,86 _____
9. R5,49 _____





1. The date on a coin tells you _____

2. What is the name of the bank on our notes?

   _____

3. What is the colour of

   (a) the R2 _____ (b) the R5 _____

   (c) the R10 _____ (d) the R20 _____

4. Which new coins have flowers on the front?

   _____

5. Which new coins have birds on the front?

   _____

6. Which new coins have buck on the front?

   _____

7. Which new coins show the national bird of South Africa?.

   _____

8. Which new coins show the national flower of South Africa?.

   _____

MONEY

Name:



= _____



= _____



= _____

How much?

=

=

Is the change correct? ✓ ✗

Gave R1.00 ☐

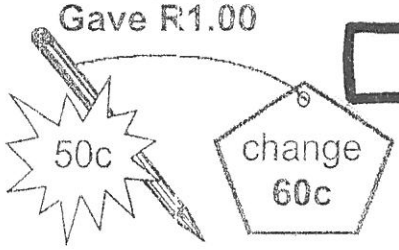

Gave R2.00 ☐



Gave R5.00 ☐

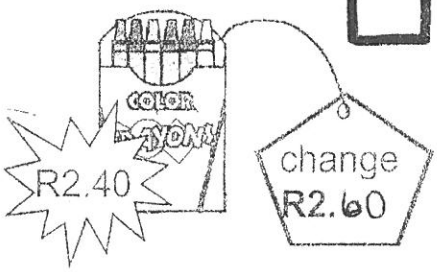

Gave R5.00 ☐



Rands and cents

a) R1 = 100c

b) 500c = R____

c) R3 = _____c

d) R2,50 = _____c

e) 400c = _____

f) 650c = _____

g) R1,20 = _____c

h) 200c = _____

i) R8,00 = _____c

Buying and saving

1. Study Advertisements A and B.



Advertisement A



Advertisement B

In which advertisement are the following items cheaper and by how much?

bread _____ _____

coffee _____ _____

chicken _____ _____

a) sugar (A) + cookies (A)

_____ + _____ = _____

b) mealie meal (B) + bread (B)

_____ + _____ = _____

c) coffee (B) + bread (A)

_____ + _____ = _____

d) cookies (A) + sugar (A)

_____ + _____ = _____

Story sums

a) Dad gave me R20,00. I gave R10,00 to my brother. Now I have _____ left.

b) Peter had R16,00. His mom doubled it. Now he has _____

c) Mom had R25,00. She gave R12,00 to Tom for a movie and R3,00 to Jane for a book. How much is left? _____

d) Thabo bought a chocolate for R2,00, chips for R1,50 and a sucker for 50c. How much did he spend? _____